Name _____ Datum _____

Akkordumkehrungen

Akkordumkehrungen bestimmen

Gib für jeden Akkord an, ob er in Grundstellung, erster oder zweiter Umkehrung steht.



Akkorde schreiben

Schreibe jeden Akkord ins Notensystem.

C/E



G/D



Dm/F



Am/C



A/E



C/G

