Name _____ Datum _____

Feinbestimmung von Intervallen

Intervalle bestimmen

Schreibe die vollständige Intervallbezeichnung unter jedes Intervall.



Intervalle schreiben

Schreibe über jede vorgegebene Note eine Note, sodass das angegebene Intervall entsteht.

kleine Terz



reine Quinte



große Septime



große Sekunde



kleine Sexte



reine Quarte

