Name _____ Datum _____

Intervalle

Intervalle bestimmen

Schreibe den Namen des Intervalls unter jedes Intervall.



Intervalle schreiben

Schreibe über jede vorgegebene Note eine Note, sodass das angegebene Intervall entsteht.

Sekunde



Quinte



Oktave



Terz



Septime



Quarte

